Contents

Chapters

1 Numbers up to 20 3
20 questions · Answers p. 153

2 Number Bonds 15
20 questions · Answers p. 156

3 Addition and Subtraction within 20 27
20 questions · Answers p. 158

4 Ordinal Numbers and Position 37
20 questions · Answers p. 161

5 Numbers up to 100 47
20 questions · Answers p. 164

6 Addition and Subtraction within 100 59
20 questions · Answers p. 167

7 Multiplication and Division 72
20 questions · Answers p. 170

8 Money 86
20 questions · Answers p. 173

9 Length 98
20 questions · Answers p. 175

10 Time 111
20 questions · Answers p. 177

11 2D Shapes 124
20 questions · Answers p. 180

12 Picture Graphs 135
20 questions · Answers p. 183

Answers

Chapters 1 to 12: every answer with its working 152

CHAPTER 1

Numbers up to 20

20 workbook questions



In this chapter

20 questions, 36 marks. Show your working in the space given and write your answer on the answer line. The answers are on page 153.

- Set A: Practice: 8 questions, 8 marks
- Set B: Apply: 8 questions, 16 marks
- Set C: Problem Sums: 4 questions, 12 marks

Name: _____ Class: _____ Date: _____

PRIMARY 1 · MATHEMATICS · NUMBERS UP TO 20

Numbers up to 20

INSTRUCTIONS

- 20 questions, 36 marks in total.
- Answer all questions in the spaces provided.
- Show your working in the space below each question.

Set A: Practice

Write your answers in the spaces given.

1 How many cars are there?



Ans: _____ cars [1]

2 How many kites are there? Write the number in words.

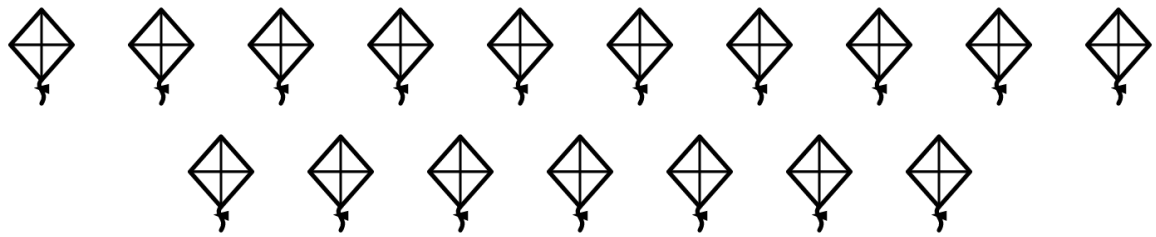

Ans: _____ [1]

3 What number do the ten frames show?

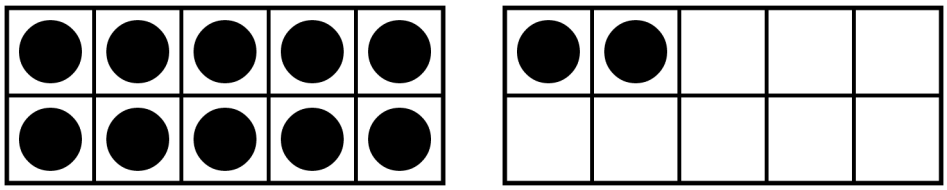

Ans: _____ [1]

4 Fill in the blank.

1 ten and 6 ones make ____. [1]

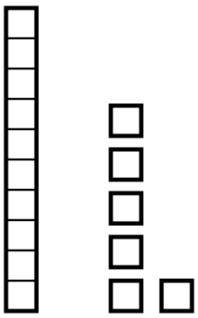

5 Look at the cats and the dogs. Which are fewer, the cats or the dogs?

cats 

dogs 

Ans: _____ [1]

6 Circle the smallest number.

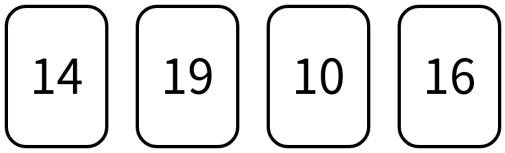

[1]

7 Count on by 1. What number goes in the box?

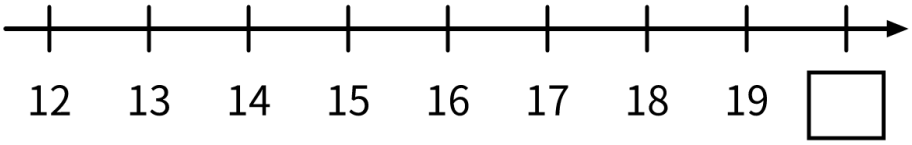

Ans: _____ [1]

8 Colour 13 circles.



[1]

Set B: Apply

Each question has two parts or two steps. Show how you know.

9 Look at the number cards.

thirteen	20	eleven	18

(a) Write the smallest number as a numeral.

Ans: _____ [1]

(b) Write the greatest number in words.

Ans: _____ [1]

10 Look at the ten frames.

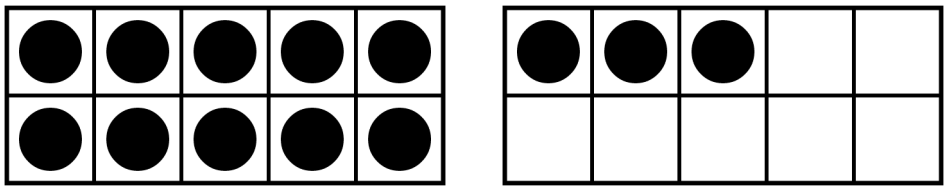

(a) How many counters are there? Write the number in words.

Ans: _____ [1]

(b) How many more counters are needed to fill both ten frames?

Ans: _____ counters [1]

11 Fill in the blanks.

(a) 15 = ____ ten and ____ ones

[1]

(b) 2 tens = ____

[1]

12 Look at the bowls and the spoons.



(a) Which are fewer, the bowls or the spoons?

Ans: _____ [1]

(b) Each bowl needs 1 spoon. How many more spoons are needed?

Ans: _____ spoons [1]

13 Lina says this. Is she correct? Explain.



[2]

14 Arrange the numbers in order. Begin with the smallest.

16	10	19	7	13

Ans: _____ [2]

15 Count back by 1. Write the missing numbers in the cards.



[2]

16 Look at the number track.

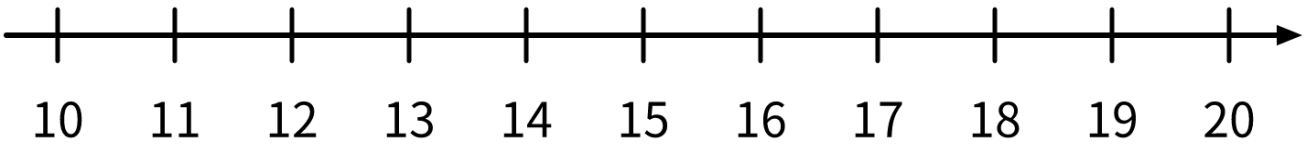

(a) What number is between 13 and 15?

Ans: _____ [1]

(b) Write the two numbers that are greater than 17 and smaller than 20.

Ans: _____ [1]

Set C: Problem Sums

Read each question carefully. Write your answers in the spaces given.

17 Mr Ali puts 10 oranges in a bag. He has 8 more oranges on the table.

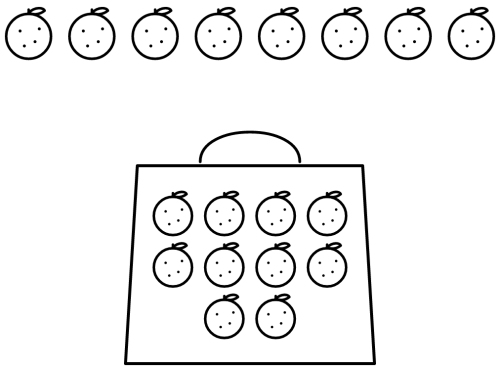

(a) Fill in the blanks.
10 and ____ more make ____.

[1]

(b) How many oranges does Mr Ali have? Write the number in words.

Ans: _____ [1]

(c) Mrs Tan has 20 oranges. How many more oranges must Mr Ali get to have as many as Mrs Tan?

Ans: _____ oranges [1]